Составление неравенств из цифровой прямой Имя:

Составьте неравенство, выражающее цифровую прямую.

об) 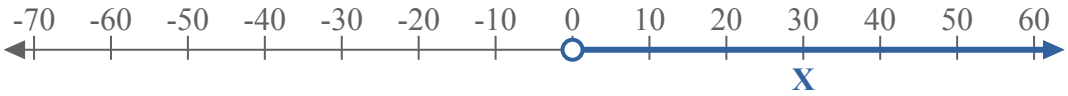

1) 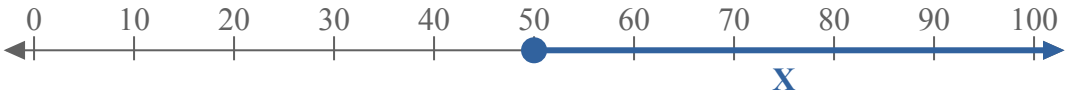

2)

3) 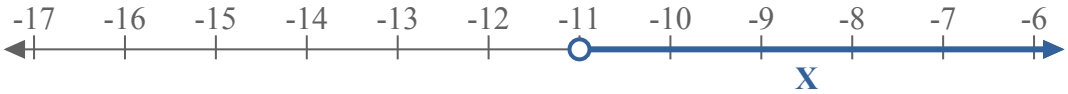

4)

5) 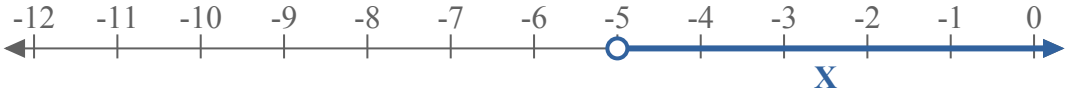

6) 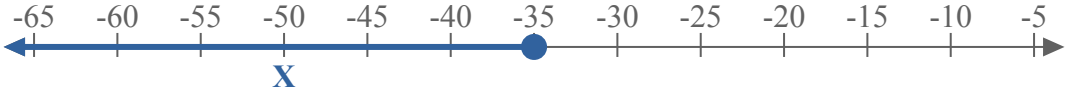

7) 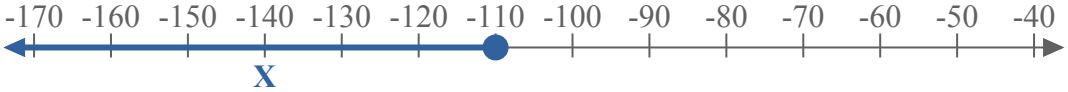

8) 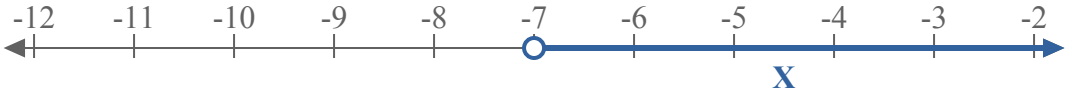

9) 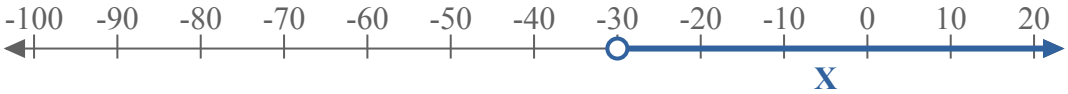

10) 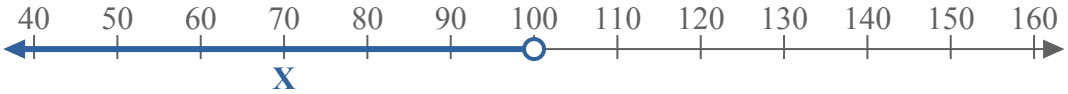

11) 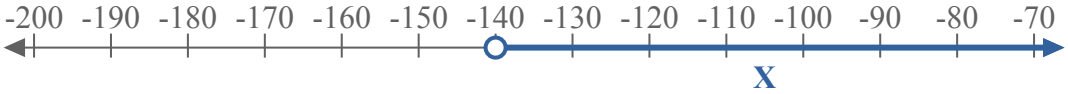

12) 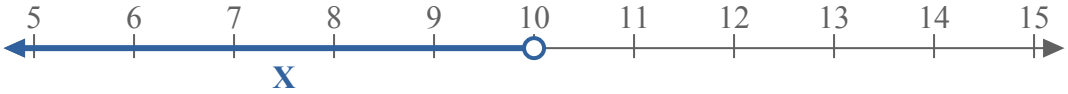

13) 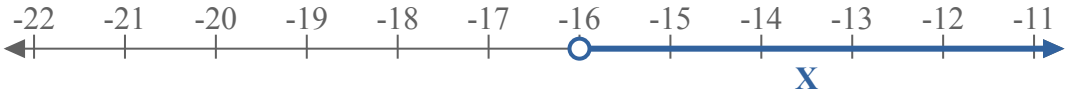

Ответы

об. X > 0

1. _____

2. _____

3. _____

4. _____

5. _____

6. _____

7. _____

8. _____

9. _____

10. _____

11. _____

12. _____

13. _____

1-10	92	85	77	69	62	54	46	38	31	23
11-13	15	8	0							

Составление неравенств из цифровой прямой Имя: Ключ к правильным ответам

Составьте неравенство, выражающее цифровую прямую.

об)
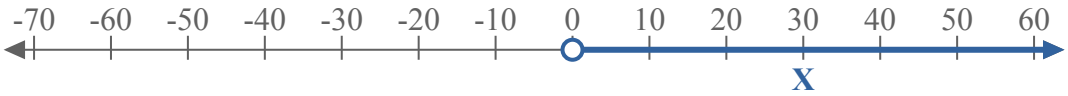

1)
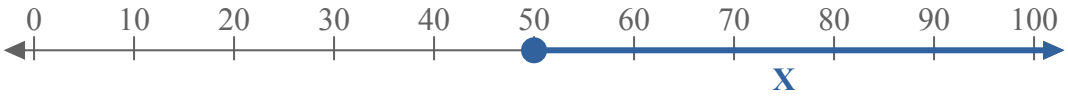

2)

3)
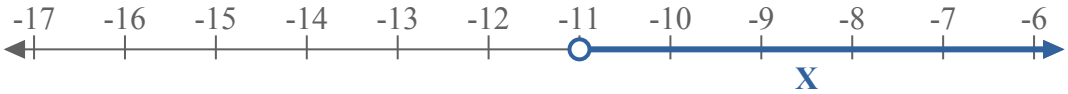

4)

5)
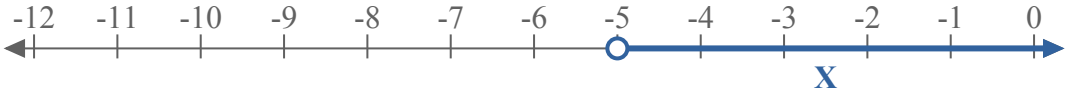

6)
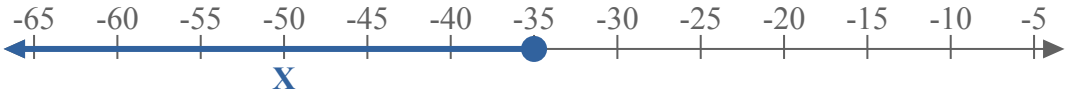

7)
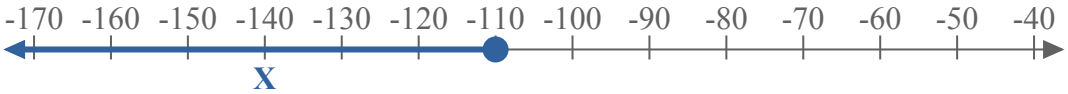

8)
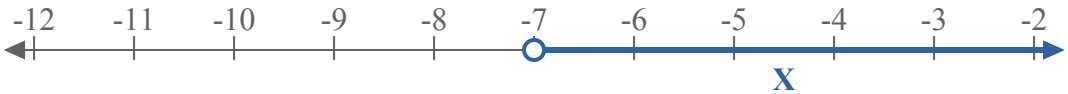

9)

10)
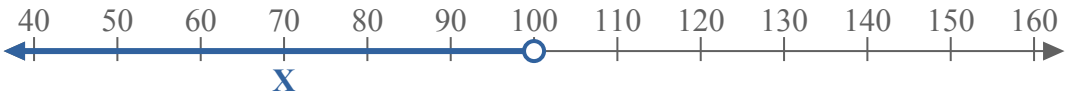

11)
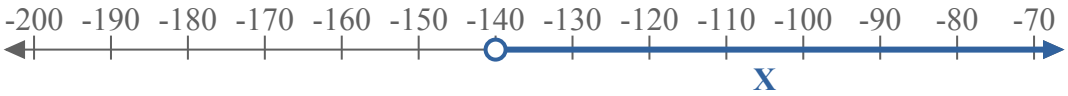

12)
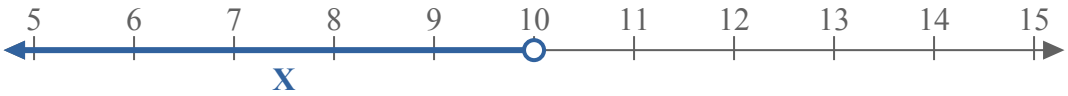

13)
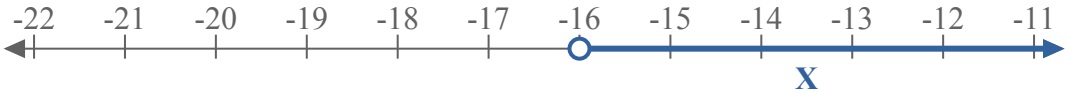

Ответы

об. $X > 0$

1. $X \geq 50$

2. $X > -150$

3. $X > -11$

4. $X > 80$

5. $X > -5$

6. $X \leq -35$

7. $X \leq -110$

8. $X > -7$

9. $X > -30$

10. $X < 100$

11. $X > -140$

12. $X < 10$

13. $X > -16$

1-10	92	85	77	69	62	54	46	38	31	23
11-13	15	8	0							